Pounds and pence

1 How much money is there?

38 p



£ 38

What is the same and what is different?

2

a) Complete the statements.

There is 4 pounds.

There is 75 pence.

There is £ 4 and 75 p.

There is £ 4.75

b) Draw money so that there are fewer coins but the same total amount.

e.g.

3 Match the amounts that are equal.

Fill in the missing digits.

460p	£ 4 and 60 p	£4.62
420p	£4 and 62p	£4.06
406 p	£4 and 6p	£4.20
462p	£4 and 20p	£ 4.26
426p	£4 and 26p	£4.60

4 Match the person to the correct amount.

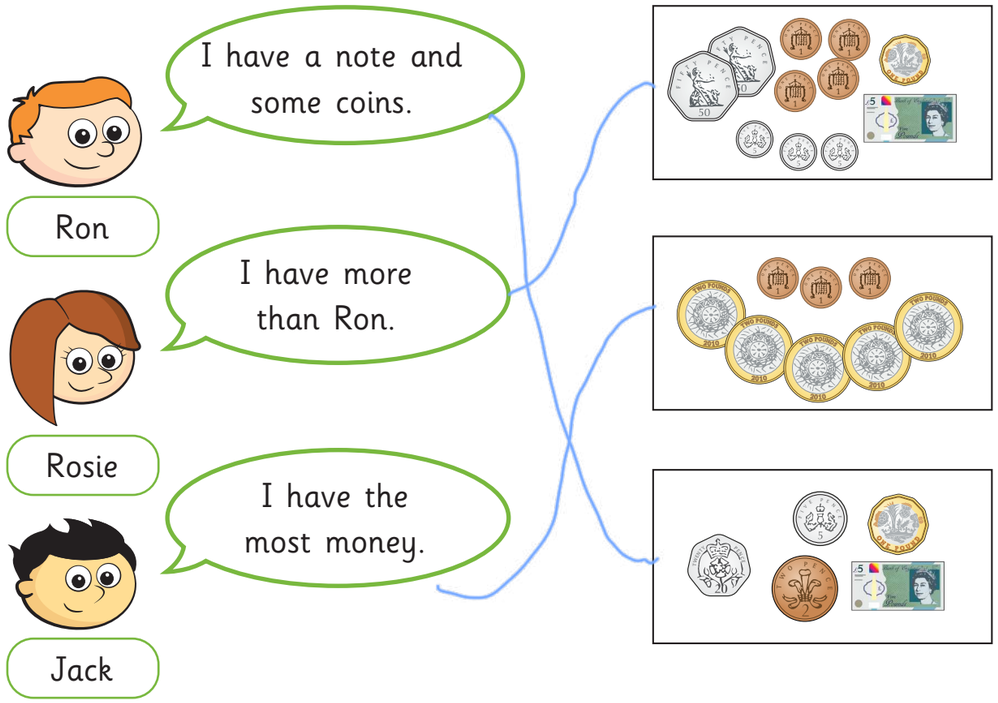

© White Rose Maths 2020

5 Amir has a note in his pocket.

Annie has three coins in her pocket.

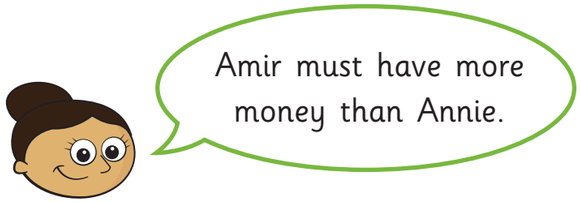

Do you agree with Dora? NO

Explain your answer.

Amir could have a £5 note and Annie could have three £2 coins.

6 Kim has four coins.

- The coins add to a multiple of 10
- The total amount is more than £1
- All the coins are silver.
- The total is less than £1.50

a) Which four coins could Kim have?

e.g. 50p 50p 20p 10p

b) How many different combinations can you find?

7 Mo has this money.

Decide whether Mo's statements are true (T) or false (F).

Circle your answer and give a reason for your choice.

a) 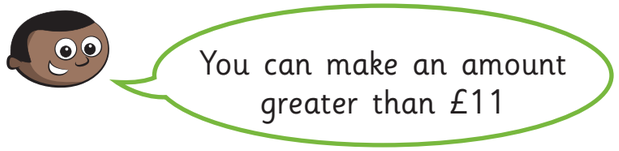

T F

Mo has £11.21 altogether.

b) 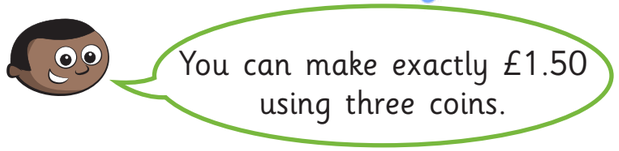

T F

No combination of 3 coins makes £1.50

c) 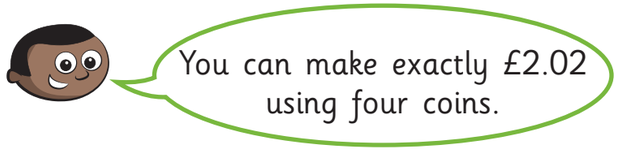

T F

£1 + 50p + 50p + 2p = £2.02

d) 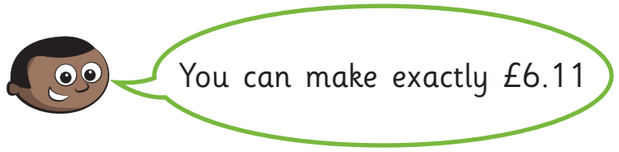

T F

£5 + £1 + 5p + 2p + 2p + 2p = £6.11

© White Rose Maths 2020